සියලු ම හිමිකම් ඇවිරිණි / All Rights Reserved

වයඹ පළාත් අධ්‍යාපන දෙපාර්තමේන්තුව
Provincial Department of Education - NWP

තෙවන වාර පරීක්ෂණය - 2025
Third Term Test - 2025

Grade 08 | **WESTERN MUSIC** | **02 Hours**

Name / Index No. :

Answer all questions on this paper itself.

UNDERLINE THE MOST SUITABLE ANSWER

01. The bird can imitate other birds and also specially the 'cat' s meaow

(1) Magpie - robin (2) Koel (3) Shama (4) Common drongo

02. Which of the following drum is not used for Hevisi pooja perahara

(1) Thammattama (2) Daula (3) Gataberaya (4) Udekkiya

03. The instrument not used in the Baroque period is?

(1) Harpsichord (2) Clavichord (3) Church Organ (4) Piano

04. Which of the following composer wrote Moonlight sonata?

(1) Beethoven (2) Mozart (3) Haydn (4) Handel

05. Which of the following is a definite pitch percussion instrument.

(1) Kettle drum (2) Side drum (3) Bass drum (4) Tenor drum

06. Which of the following instrument is known as the "Cinderella" of the orchestra?

(1) Violin (2) Viola (3) Violoncello (4) Double bass

07. A Chromatic semitone higher than the given note is



08. What is the English meaning of the Italian term "Allegro"

(1) Slow (2) Loud (3) Soft (4) Fast

09. The correct time signature for the given melody is?



(1) $\frac{2}{4}$ (2) $\frac{3}{4}$ (3) $\frac{4}{4}$ (4) $\frac{3}{8}$

Past Papers Wiki

10. What is the correct way of writing "whole bar rest" ?

(1) (2) (3) (4)

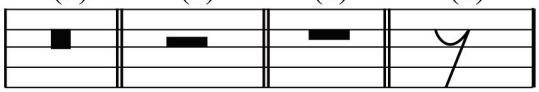

11. Which of the following is not a qualifying name for the intervals?

(1) Perfect (2) Major (3) Minor (4) Tone

12. How many notes are there in a triad?

(1) 3 (2) 1 (3) 4 (4) 6

13. Which of the following note is "A"



(1) (2) (3) (4)

14. The key signature of the scale E♭ major is?



(1) (2) (3) (4)

15. How many sections present in the Binary form?

(1) 3 (2) 4 (3) 1 (4) 2

16. Which of the following is the correct answer after transposing the given note an octave higher



(1) (2) (3) (4)

17. The height or depth of a sound is called,

(1) Vibration (2) Amplitude (3) Pitch (4) Frequency

18. Which of the following songs is not an "old favourite"?

(1) Banana boat song (2) Jamaican farewell

(3) Yellow bird (4) Old folks at home

19. Which of the following is the correct position of playing the given note



(1) 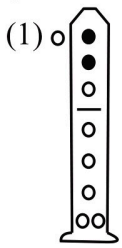

(2) 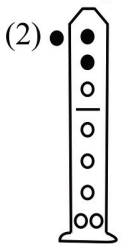

(3) 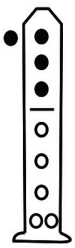

(4) 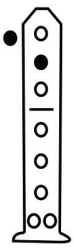

20. How many lines and spaces are there in the Great staf

(1) 5 lines and 4 spaces (2) 4 lines and 5 spaces

(3) 10 lined and 11 spaces (4) 11 lines and 10 spaces

- **Answer only 3 questions including the first question.**

01. Study the musical extract given below and answer the questions.

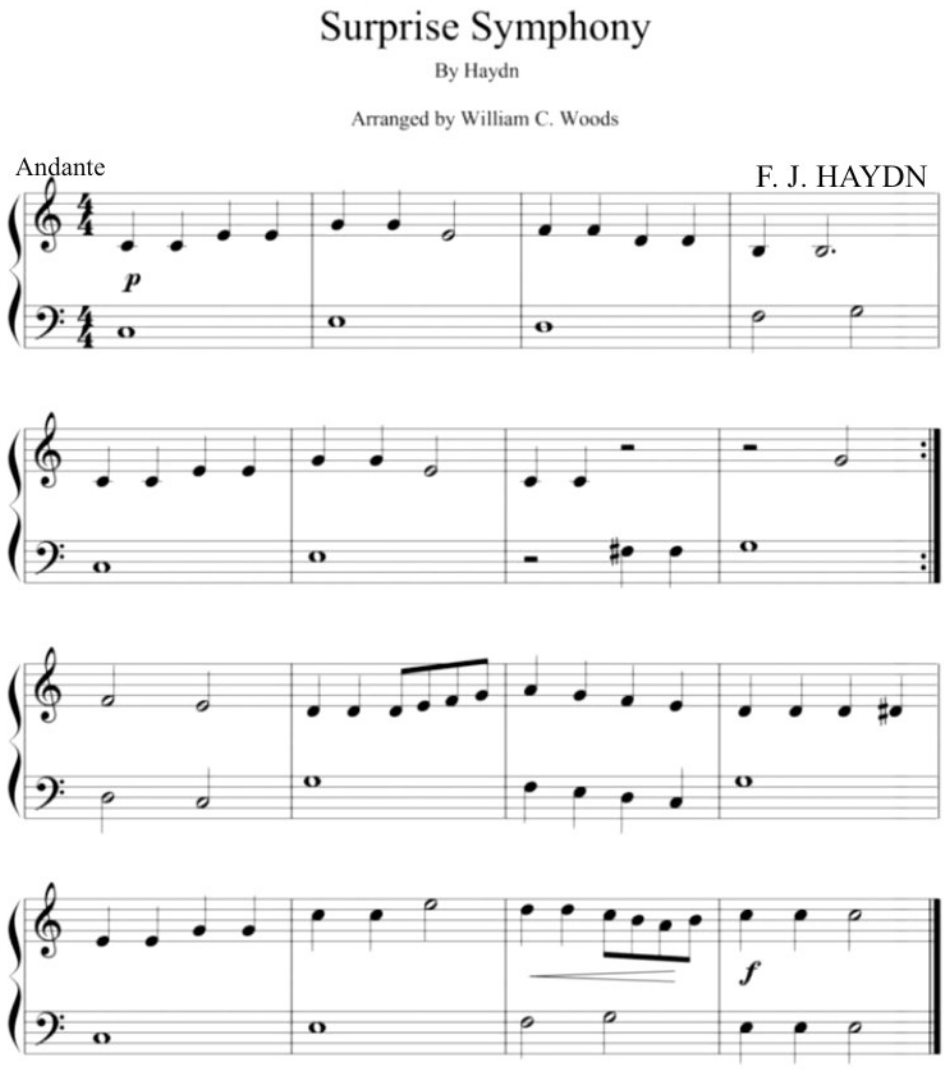

(i) Write the title of the piece ..... (1)

(ii) Write the Nationality of the composer ? ..... (1)

(iii) Write the English meaning of the Tempo mark ? ..... (1)

(iv) Give the English meaning of the following two dynamic marks ?

1. "P" ..... 2. "<" ..... (2)

(v) Circle the lowest note and name it ..... (2)

(vi) Name the rest mark in the piece ..... (1)

(vii) What is the shortest note value in the piece ..... (1)

(viii) Describe the time signature ..... (1)

(10 marks)

02 (a) Write the following scales as required

(1) Ascending scale of D major with key signature in minims. (3 marks)



(2) Descending scale of B♭ major, without key - signature in semibreves. (3 marks)



(b) Write the enharmonic equivalent of the following notes.



(2 x 2 = 4)

03. (a) Name the following intervals.



(2 x 3 = 6)

.....

(b) Add the correct time signature



(1 mark)

(c) Add the proper rest or rest



(1 mark)

(d) Add bar lines

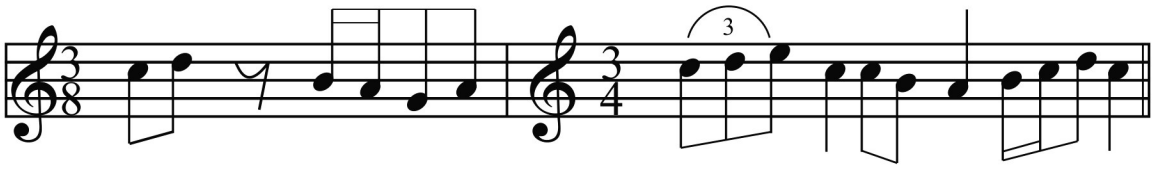

(1 x 2 = 02)

04. Complete the puzzle.

Across → - 1. The composer known as the shakespeare in music
2. An oratorio composed by Haydn
3. A composition for one performer is known as?
4. When the time is in three it is in .....
5. The highest pitch string instrument.
6. The song "Banana boat" belongs to ?

Down ↓ - 3. The Technical name for the 2nd note of a scale
7. One way of lengthening a note
8. Another name for 3 part form
9. Number of strings in a guitar. (1x10 = 10 marks)



PAST PAPERS WIKI

සියලු ම හිමිකම් ඇවිරිණි / All Rights Reserved

වයඹ පළාත් අධ්‍යාපන දෙපාර්තමේන්තුව Provincial Department of Education - NWP

වයඹ පළාත් අධ්‍යාපන දෙපාර්තමේන්තුව
Provincial Department of Education - NWP

අවසාන වාර පරීක්ෂණය - 2025
Third Term Test - 2025

Grade 08

WESTERN MUSIC

PRACTICAL TEST

01. Recorder Scales

    1. C major

    2. D major (5 x 2 = 10 marks)

02. Piano Scales

    1. C major

    2. D major (5 x 2 = 10 marks)

03. Singing (song relavent to grade 8 syllabus) (10 marks)

04. Any Recorder or piano piece (10 marks)

05. Clap the given rhythm



(5 marks)

06. Sing any scale given by the teacher

    C major / D major / B major (5 marks)

Past Papers Wiki

Paper - I

01. (4)	02. (4)	03. (4)	04. (1)	05. (1)	06. (2)	07. (4)	08. (4)	09. (2)	10. (3)
11. (4)	12. (1)	13. (3)	14. (1)	15. (4)	16. (1)	17. (3)	18. (4)	19. (2)	20. (3)

(1 x 20 = 20)

Paper - II

01. (i) Surprise symphony (01 mark)
(ii) Austrian (01 mark)
(iii) At a moderate space /At a medium speed (01 mark)
(iv) 1. Soft 2. Getting gradually louder (02 marks)
(v) C (02 marks)
(vi) Minim rest (01 mark)
(vii) Quaver (01 mark)
(viii) Simple quadruple with four crotchets beats in a bar (01 mark)

02. (a)
(i)
(ii)
(b)



(03 marks)
(03 marks)
(2 x 2 = 04 marks)

03. (a) (1) Perfect 4th (ii) Major 7th (iii) Major 3rd (2 x 3 = 06 marks)
(b) $\frac{4}{4}$ (01 mark)
(c)
(d)



(01 mark)



(1 x 2 = 02 marks)

04.

					[7]D						
[1]B	e	e	[8]t	h	0	v	e	n			
	[2]c	r	e	a	t	i	o	n			
			r								
			n		[3]S						
			a		u						
		[4]T	r	i	p	l	e				
			y		e						
					r						
					t		[9]				
			[5]v	i	o	l	i	n			
					n						
					i						
					[6]C	a	l	y	p	s	o

(1 x 10 = 10 marks)

PAST PAPERS WIKI
WWW.PastPapers.WiKi
Downloaded From Past Papers WiKi - Sri Lanka's Largest Past Paper Bank