සියලුම හිමිකම් ඇවිරිණි/முழுப் பதிப்புரிமையுடையது/All Rights Reserved

දකුණු පළාත් අධ්‍යාපන දෙපාර්තමේන්තුව
தென் மாகாணக் கல்வித் திணைக்களம்
Department of Education, Southern Province

අවසාන වාර පරීක්ෂණය - 2025
இறுதி தவணைப் பரீட்சை - 2025 / Year End Term Test - 2025

| ශ්‍රේණිය தரம் Grade | Grade 6 | Western Music I | කාලය நேரம் Time | 1/2 hrs |
|---|---|---|---|---|

නම பெயர் Name ..... විභාග අංකය சுட்டிலக்கம் Index No. .....

# Part I

- **Answer all questions.**
- **Underline the correct answer.**

1. An example for man-made sound?
   1. The splatter of Rain 2. Rustling of leaves 3. Sea Waves 4. Cuckoo clocks

2. The sound at different situations can be imitated in a very interesting way. Nimal Mendis "Kandyan Express "is a very good example for this. In this music it imitates.
   1. Sound of a bus 2. Sound of a Train 3. Sound of a Lorry 4. Sound of a Bird

3. A key board instrument is,
   1. Accordion 2. Snare Drum 3. Tambourine 4. Trumpet

4. The Sri Lankan drum specially associated with southern province.
   1. Daula 2. Yak beraya 3. Gata beraya 4. Bummadiya

5. An example for old music.
   1. Air on G String 2. Pink Panther 3. Rhapsody in blue 4. Entertainer

6. Waltz is a,
   1. March in Triple Time 2. Dance in Triple Time
   3. Dance in Duple Time 4. March in Duple Time

7. A rhythmical walk-in duple sound as "Left, Left, Left -Right, Left",
   1. March 2. Waltz 3. Rhythm 4. All of the above

8. The given note in Soprano recorder.



1.  2.  3.  4. 

Past Papers Wiki

9. What is the letter name of the first note in "Marry had a little Lamb "that you played on the Recorder?

1. F 2. G 3. A 4. B

10. Given note on the Key board,



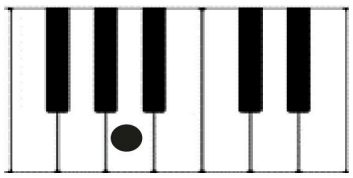

1.

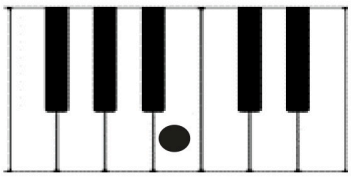

2.

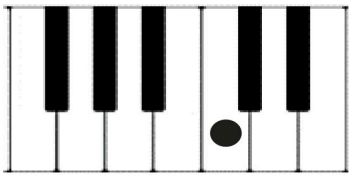

3.

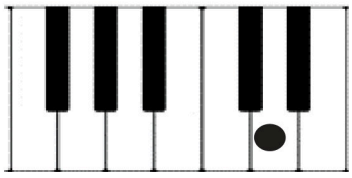

4.

11. The person who stood in front of the orchestra is,

1. Percussion player 2. Wood wind player 3. Conductor 4. Bass drummer

12. What is the highest note in the given melody,



1. D 2. A 3. C 4. E

13. The sign that uses to indicate silence in Music,

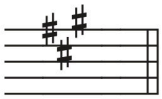

1.



2.



3.



4.

14. Correct way of writing Middle C,

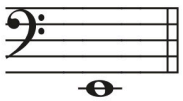

1.



2.



3.



4.

15. Name the notes to find the hidden words.



1. BEG 2. BAD 3. BAG 4. GFE

16. Correct order of naming the scale using solfa names.

1. Doh, Ray, Me, Fah, Lah, Soh, Te
2. Doh, Me, Ray, Fah, Lah, Soh, Te
3. Doh, Fah, Me, Ray, Lah, Soh, Te
4. Doh, Ray, Me, Fah, Soh, Lah, Te

17. Total number of counts in these notes,



1. 6
2. 7
3. 8
4. 9

18. $\frac{2}{4}$



Twin -kle Twin - kle lit - tle star

The song is in,

1. Duple Time
2. Waltz Time
3. Triple Time
4. 3 beat time

19. Most suitable time signature to this rhythm is,



1. $\frac{2}{4}$
2. $\frac{3}{4}$
3. $\frac{4}{4}$
4. $\frac{4}{2}$

20. This means



1. Detached Short
2. Smooth Connected
3. Gradually Louder
4. Gradually Softer

(20 Marks)

සියලුම හිමිකම් ඇවිරිණි/முழுப் பதிப்புரிமையுடையது/All Rights Reserved

දකුණු පළාත් අධ්‍යාපන දෙපාර්තමේන්තුව
தென் மாகாணக் கல்வித் திணைக்களம்
Department of Education, Southern Province

අවසාන වාර පරීක්ෂණය - 2025
இறுதி தவணைப் பரீட்சை - 2025 / Year End Term Test - 2025

| ශ්‍රේණිය தரம் Grade | Grade 6 | Western Music II | කාලය நேரம் Time | 1 1/2 hrs |
|---|---|---|---|---|

නම பெயர் Name ..... විභාග අංකය சுட்டிலக்கம் Index No. .....

# Part II

- **Answer <u>only 3</u> questions including question No.01 and selecting 2 other questions.**

| Part II | Question | Marks |
|---|---|---|
| | 1 | |
| | 2 | |
| | 3 | |
| | 4 | |
| Total | | |

| | |
|---|---|
| Part I | |
| Part II | |
| Practical Mark | |
| Total | |

**1.** Study the music extract given below and answer the questions. (10 Marks)

# Folk Dance

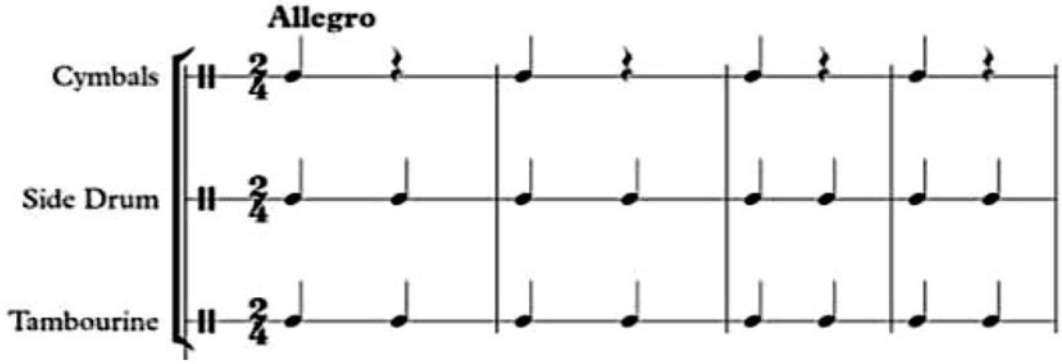


i. What is the name of the given piece…….

ii. What is the Time Signature …….

iii. Explain the Time Signature……..

iv. How many bars are there in this music……

v. Are there any rest in this music, if it is so write the time name of the given rest……..……

vi. What is the time name of the given notes……

vii. Add staccato sign to all the notes in the last bar.

viii. From which section of the orchestra are we playing this music…….

ix. Name two other instruments that belongs to this section.

1……..2……

x. Name the four main section of the orchestra.

1……

2……...

3……..

4……..

**2.** i.Give the Time name (Minim…etc) of each note marked with a * (4 Marks)




(a) …….. (b) ……

(c) …… (d) ……

Past Papers Wiki

ii. Put these note in the cage below in order of length starting with the **longest**. (2 Mark)





iii. Give the letter name and draw the equal rest given in the empty bar. (4 Marks)

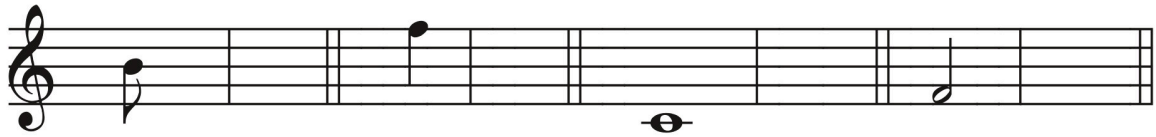

Letter Name:……

**3.** i. Write the Scale of C Major Ascending in Semibreves using Treble Clef. (2 Marks)



ii. Write the Scale of C Major descending in Semibreves using Bass Clef. (2 Marks)



iii. Colour the keys that make up the C Major scale and write their names. (2 Marks)



iv. Add bar lines according to the given Time Signature. (2 Marks)





v. Answer the following questions. (2 Marks)

a) Give the Italian term for loud?.....

b) What sign is used for gradually getting louder?.....

**4.** i. Write the first two lines of a song you sang in the class room. (1 Mark)

……

……

ii. Name two pleasant sounds in the environment. (1 Mark)

1. ……

2. ……

iii. Write a national function where you can hear the National Anthem of Sri Lanka.(1 Mark)

……

iv. Name the given Sri Lankan drums. (2 Marks)









v. Draw the following notes. (2 Marks)



F on a line  G in a Space  C in a space  D on a line

vi. Draw a Great staff and Mark **Middle C**. (3 Marks)

PAST PAPERS WIKI

WWW.PastPapers.WiKi



Downloaded From Past Papers WiKi - Sri Lanka's Largest Past Paper Bank